Sec.11

# EGM 3520 Mechanics of Materials (MoM)

Beer et al. 2012, Mechanics of Materials, McGraw-Hill.

## P3.11, p.155

P3.11, p.155

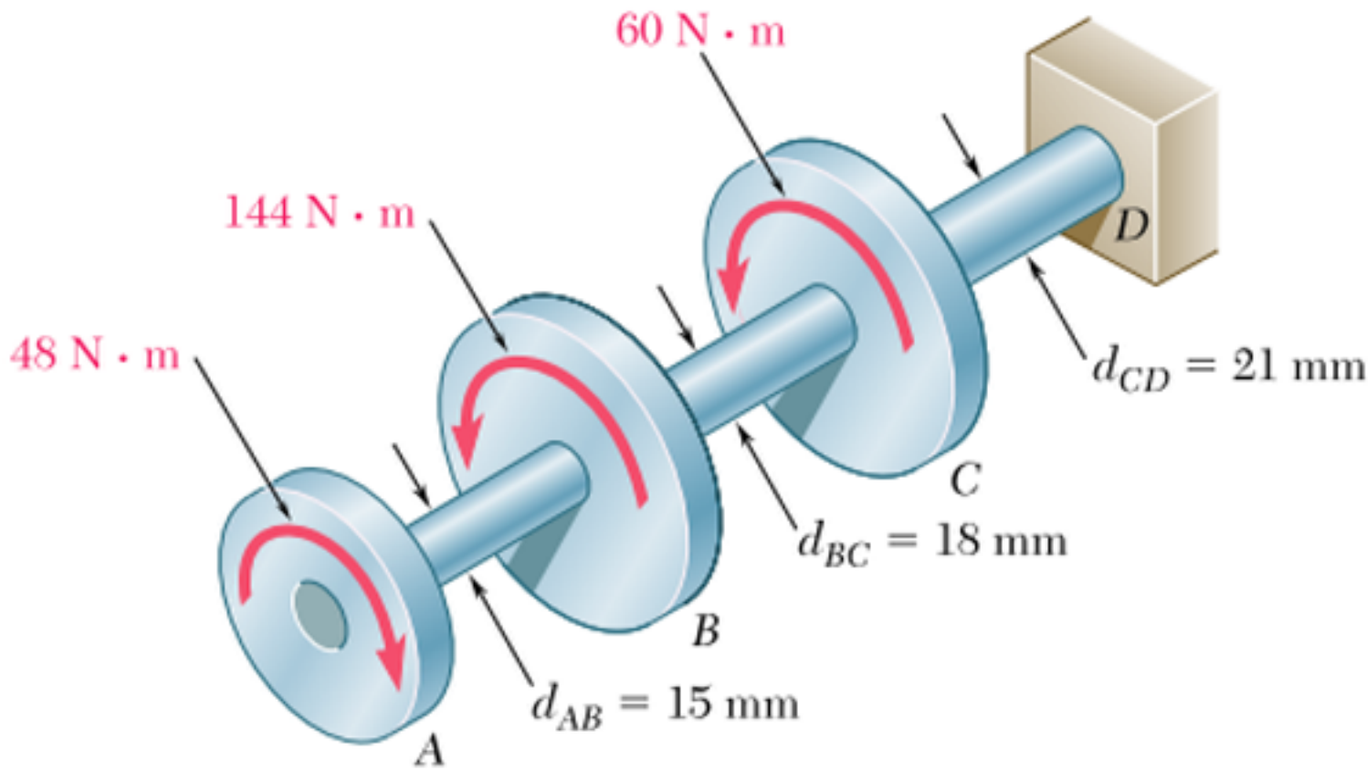


Knowing that each of the shafts *AB*, *BC*, and *CD* consists of a solid circular rod, determine (*a*) the shaft in which the maximum shearing stress occurs, (*b*) the magnitude of that stress.

Pause video NOW !

Work out the next step

→ on your own first

→ discuss with teammates

if you get stuck

then continue to watch the video

"Intelligence consists of this; that we recognize the similarity between different things, and the difference between similar things."

Baron de la Brède et de Montesquieu (1689-1755)

quoted in [Quantum field theory, E. Zeidler, 2008, p.175]

# FBDs



Pause video NOW !

Work out the next step

→ on your own first

→ discuss with teammates

if you get stuck

then continue to watch the video

"Intelligence consists of this; that we recognize the similarity between different things, and the difference between similar things."

Baron de la Brède et de Montesquieu (1689-1755)

quoted in [Quantum field theory, E. Zeidler, 2008, p.175]

FBDs

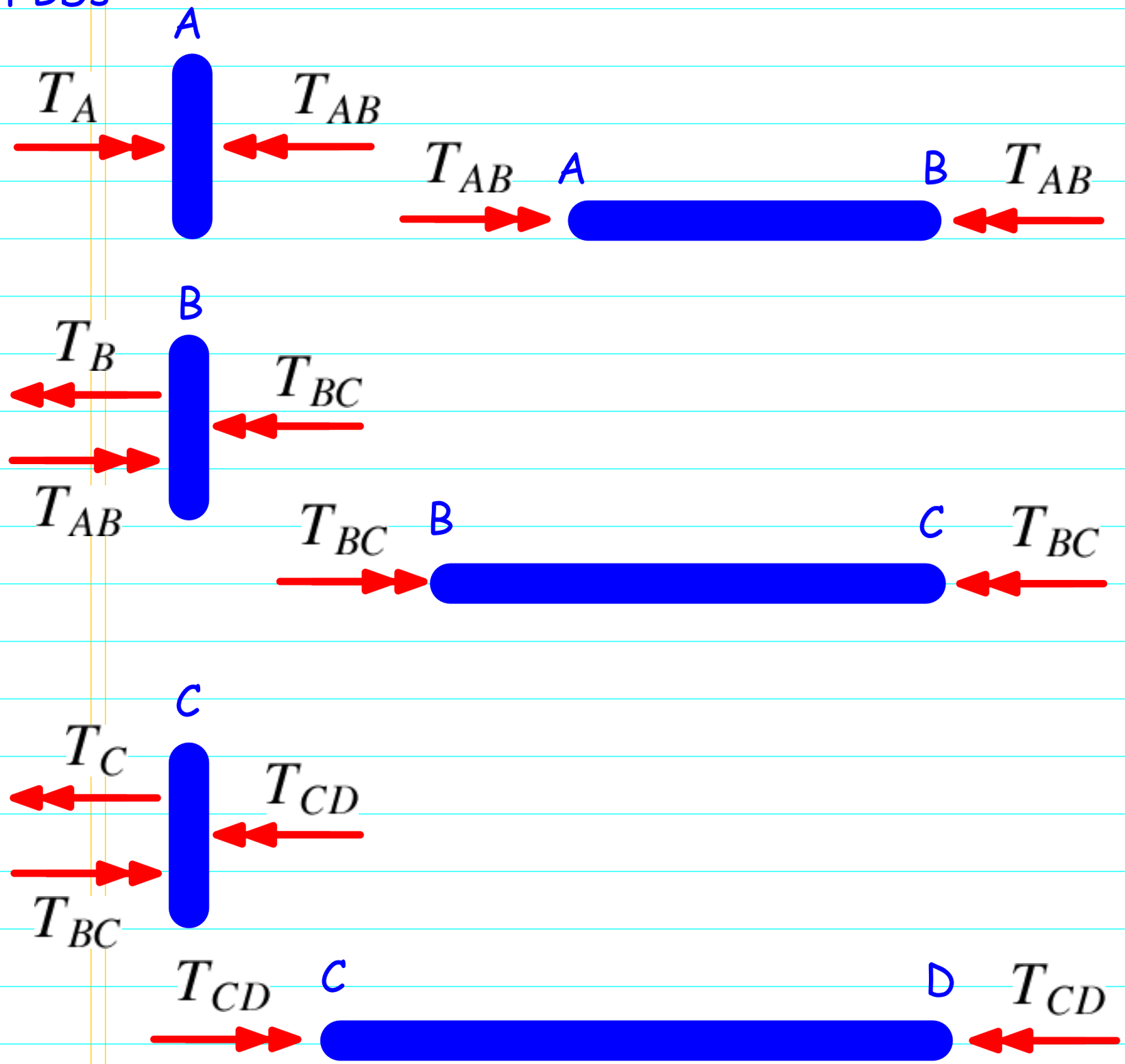

## Method

FBD of disk A

deduce $T_{AB}$ in terms of $T_A$

FBD of disk B

deduce $T_{BC}$ in terms of $T_A$ , $T_B$

FBD of disk C

deduce $T_{CD}$ in terms of $T_A$ , $T_B$ , $T_C$

Knowing the internal torque applied on each shaft, and knowing the diameter of each shaft, you can now compute the maximum shear stress on each shaft, using the elastic torsion formulas (or better yet re-formulate these formulas).

Does the length of each shaft matter ?

Pause video NOW !

Work out the next step

→ on your own first

→ discuss with teammates

if you get stuck

then continue to watch the video

"Intelligence consists of this; that we recognize the similarity between different things, and the difference between similar things."

Baron de la Brède et de Montesquieu (1689-1755)

quoted in [Quantum field theory, E. Zeidler, 2008, p.175]

## Computation

FBD of disk A $T_{AB} = T_A$ (1)

T_{AB} = T_A

FBD of disk B $T_{BC} = T_{AB} - T_B = T_A - T_B$ (2)

T_{BC} = T_{AB} - T_B = T_A - T_B

FBD of disk C $T_{CD} = T_{BC} - T_C = T_A - T_B - T_C$

T_{CD} = T_{BC} - T_C = T_A - T_B - T_C (3)

Formulation of torsion problem:

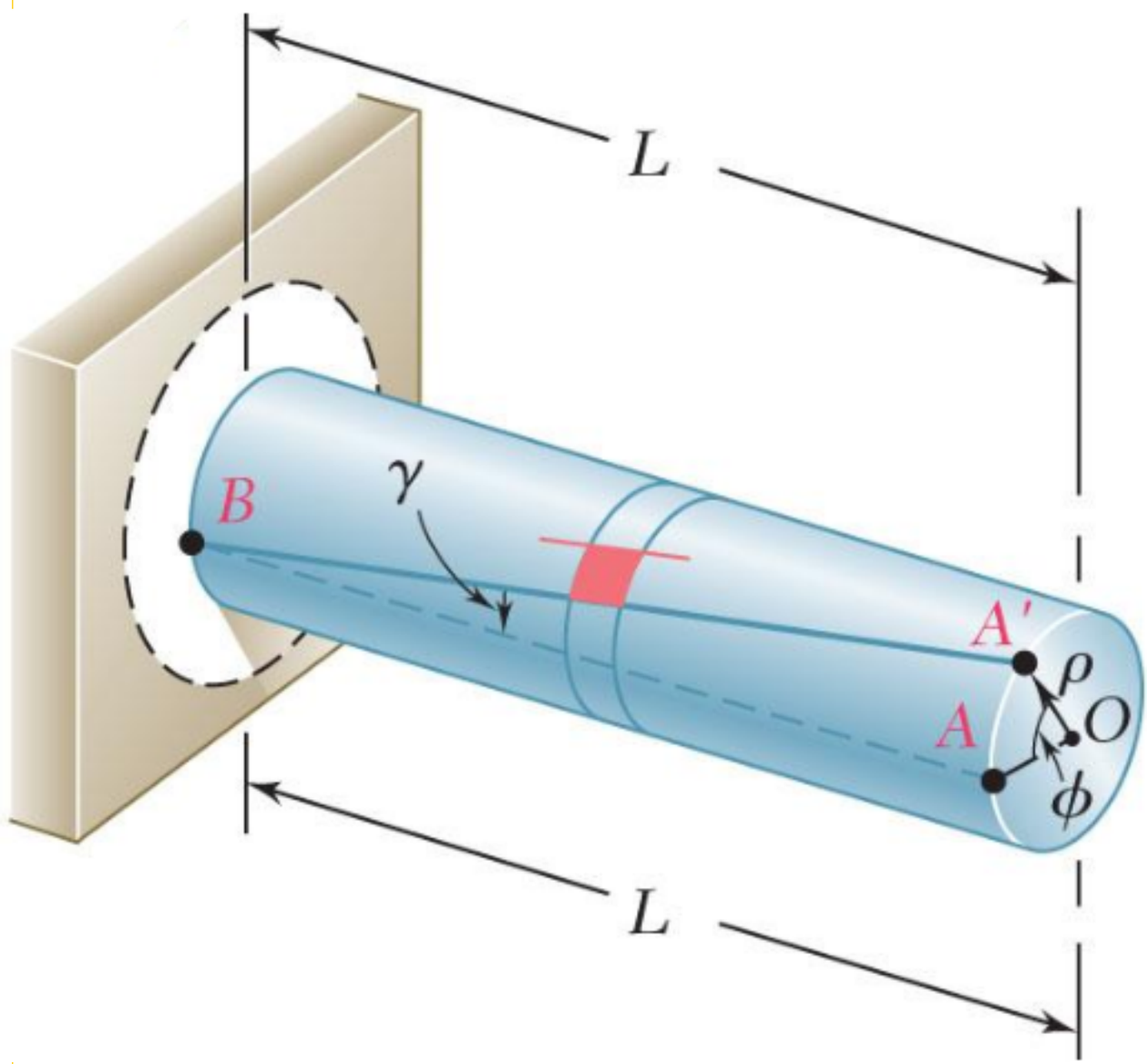

Shear in terms of angle of twist:

$$L\gamma = \rho\phi \Rightarrow \gamma = \frac{\rho\phi}{L}\ , \text{ with } 0 \le \rho \le c \qquad (1)$$

L \gamma = \rho \phi \Rightarrow \gamma = \frac{\rho \phi}{L} \ , \text{ with } 0 \le \rho \le c

$$\gamma_{max} = \frac{c\phi}{L} \Rightarrow \frac{\phi}{L} = \frac{\gamma_{max}}{c} \qquad (2)$$

\gamma_{max} = \frac{c \phi}{L} \Rightarrow \frac{\phi}{L} = \frac{\gamma_{max}}{c}

(1)-(2): $$\gamma = \frac{\rho\phi}{L} = \frac{\rho\gamma_{max}}{c} \qquad (3)$$

\gamma = \frac{\rho \phi}{L} = \frac{\rho \gamma_{max}}{c}

Hooke's law: $$\tau = G\gamma = G\frac{\rho\gamma_{max}}{c} \qquad (4)$$

\tau = G \gamma = G \frac{\rho \gamma_{max}}{c}

Resultant torque:

$$T = \int_A \rho\, dF = \int_A \rho\, \tau dA = G\frac{\gamma_{max}}{c}\int_A \rho^2\, dA \qquad (5)$$

T = \int_A \rho \, dF = \int_A \rho \, \tau dA = G \frac{\gamma_{max}}{c} \int_A \rho^2 \, dA

$$\boxed{T = GJ\frac{\gamma_{max}}{c} = \frac{GJ}{L}\phi} \qquad (6)$$

T = GJ \frac{\gamma_{max}}{c} = \frac{GJ}{L} \phi

From the 2nd eq. in (6) p.11-6 for torsional deformation, one can observe the following similarity and difference with axial deformation (remember Montesquieu):

Axial deformation Torsional deformation

$$\delta = \frac{PL}{EA} \leftrightarrow \phi = \frac{TL}{GJ} \tag{1}$$

\delta = \frac{PL}{EA} \leftrightarrow \phi = \frac{TL}{GJ}

$$P = \frac{EA}{L}\delta \leftrightarrow T = \frac{GJ}{L}\phi \tag{2}$$

P = \frac{EA}{L} \delta \leftrightarrow T = \frac{GJ}{L} \phi

$L/(EA)$ axial flexibility

$EA/L$ axial stiffness

$L/(GJ)$ torsional flexibility

$GJ/L$ torsional stiffness

(6) p.11-6:

$$\tau_{max} = G\gamma_{max} = \frac{Tc}{J} \qquad (1)$$

\tau_{max} = G \gamma_{max} = \frac{T c}{J}

Polar moment of inertia of solid circular section:

$$J = \int_A \rho^2 dA = \int_{\rho=0}^{\rho=c} \rho^2 (2\pi\rho d\rho) = \frac{1}{2}\pi c^4 \qquad (2)$$

J = \int_A \rho^2 dA = \int_{\rho = 0}^{\rho = c} \rho^2 (2 \pi \rho d\rho) = \frac12 \pi c^4

Maximum shear stress in bar AB:

$$\tau_{max,AB} = \frac{T_{AB}\, c_{AB}}{J_{AB}} = \frac{T_A\, d_{AB}/2}{\frac{1}{2}\pi(d_{AB}/2)^4} = \frac{4T_A}{\pi(d_{AB})^3} \qquad (3)$$

\tau_{max, AB} = \frac{T_{AB} \, c_{AB}}{J_{AB}} = \frac{T_{A} \, d_{AB} / 2}{\frac12 \pi (d_{AB}/2)^4} = \frac{4 T_A}{\pi (d_{AB})^3}

Maximum shear stress in bar BC:

$$\tau_{max,BC} = \frac{T_{BC}\, c_{BC}}{J_{BC}} = \frac{(T_A - T_B)\, d_{BC}/2}{\frac{1}{2}\pi(d_{BC}/2)^4}$$

$$= \frac{4(T_A - T_B)}{\pi(d_{BC})^3} \qquad (4)$$

\tau_{max, BC} = \frac{T_{BC} \, c_{BC}}{J_{BC}} = \frac{(T_{A} - T_B) \, d_{BC} / 2}{\frac12 \pi (d_{BC}/2)^4}
= \frac{4 (T_A - T_B)}{\pi (d_{BC})^3}

Maximum shear stress in bar BC:

$$\tau_{max,CD} = \frac{T_{CD}\, c_{CD}}{J_{CD}} = \frac{(T_A - T_B - T_C)\, d_{CD}/2}{\frac{1}{2}\pi (d_{CD}/2)^4}$$

$$= \frac{4(T_A - T_B - T_C)}{\pi (d_{CD})^3} \qquad (1)$$

\tau_{max, CD} = \frac{T_{CD} \, c_{CD}}{J_{CD}} = \frac{(T_{A} - T_B - T_C) \, d_{CD} / 2}{\frac12 \pi (d_{CD}/2)^4}
= \frac{4 (T_A - T_B - T_C)}{\pi (d_{CD})^3}

Pause video NOW !

Work out the next step

→ on your own first

→ discuss with teammates

if you get stuck

then continue to watch the video

"Intelligence consists of this; that we recognize the similarity between different things, and the difference between similar things."

Baron de la Brède et de Montesquieu (1689-1755)

quoted in [Quantum field theory, E. Zeidler, 2008, p.175]

Without doing any computation, we can determine which maximum shear stress is largest as follows:

$$T_A > T_A - T_B > T_A - T_B - T_C \qquad (1)$$

T_A > T_A - T_B > T_A - T_B - T_C

$$d_{AB} < d_{BC} < d_{CD} \qquad (2)$$

d_{AB} < d_{BC} < d_{CD}

(3)-(4) p.11-8 and (1) p.11-7:

$$\tau_{max,AB} > \tau_{max,BC} > \tau_{max,CD} \qquad (3)$$

\tau_{max, AB} > \tau_{max, BC} > \tau_{max, CD}

Now use (3) p.11-8 to compute $\tau_{max,AB}$